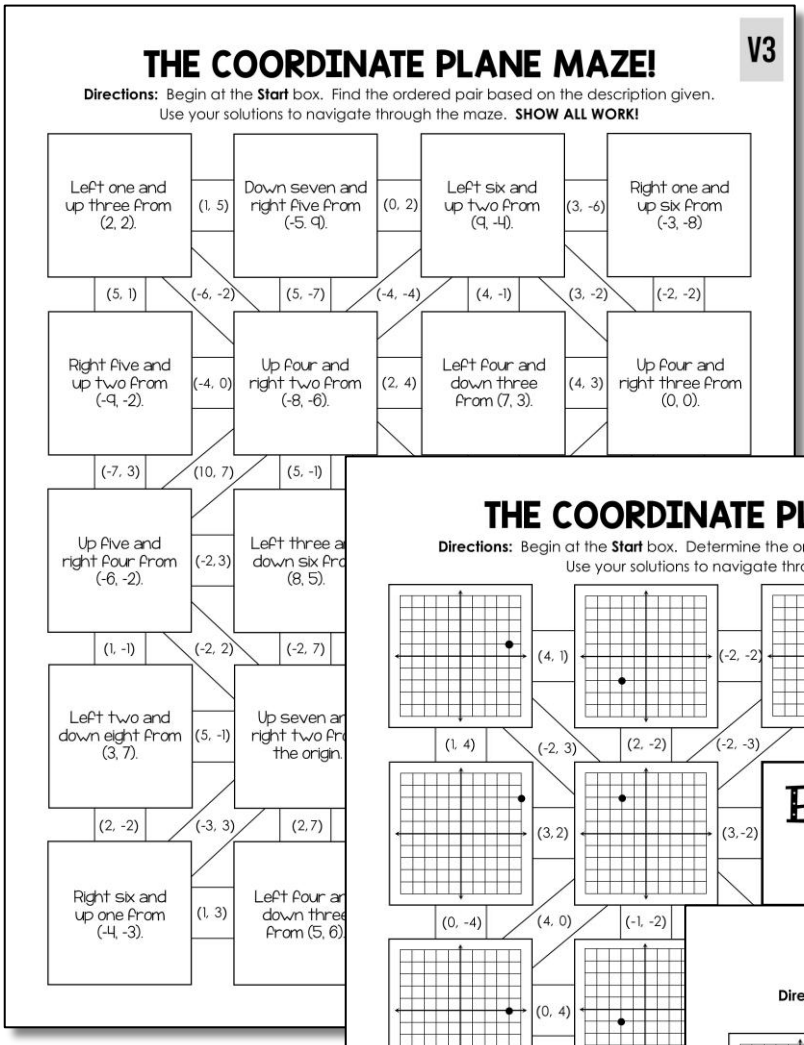
THE COORDINATE PLANE MAZE!
V3
Directions: Begin at the Start box. Find the ordered pair based on the description given.
Use your solutions to navigate through the maze. SHOW ALL WORK!
Left one and up three from (2, 2).
(1, 5)
Down seven and right five from (-5, 9).
(0, 2)
Left six and up two from (9, -4).
(3, -6)
Right one and up six from (-3, -8)
(5, 1)
(-6, -2)
(5, -7)
(-4, -4)
(4, -1)
(3, -2)
(-2, -2)
Right five and up two from (-9, -2).
(-4, 0)
Up four and right two from (-8, -6).
(2, 4)
Left four and down three from (7, 3).
(4, 3)
Up four and right three from (0, 0).
(-7, 3)
(10, 7)
(5, -1)
Up five and right four from (-6, -2).
(-2, 3)
(1, -1)
(-2, 2)
(-2, 7)
Left two and down eight from (3, 7).
(5, -1)
(2, -2)
(-3, 3)
(2, 7)
Right six and up one from (-4, -3).
(1, 3)

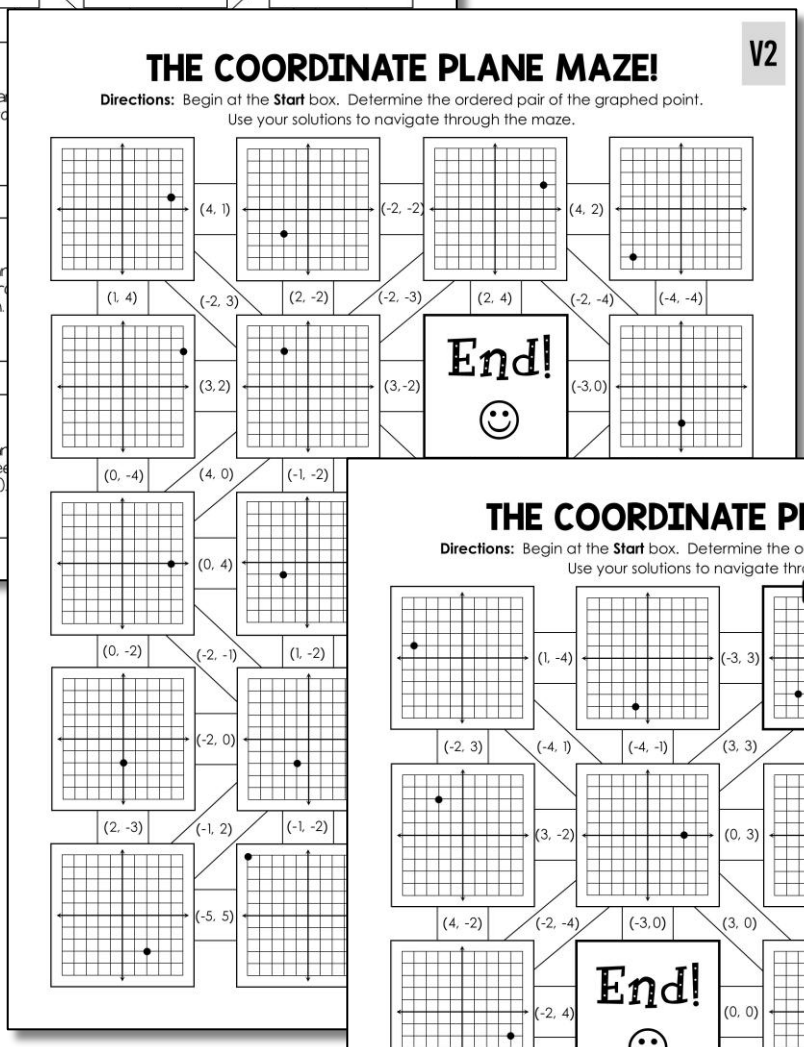
THE COORDINATE PLANE MAZE!
V2
Directions: Begin at the Start box. Determine the ordered pair of the graphed point.
Use your solutions to navigate through the maze.
(4, 1)
(-2, -2)
(4, 2)
(1, 4)
(-2, 3)
(2, -2)
(-2, -3)
(2, 4)
(-2, -4)
(-4, -4)
(3, 2)
(3, -2)
End!
(-3, 0)
(0, -4)
(4, 0)
(-1, -2)
(0, 4)
(0, -2)
(-2, -1)
(1, -2)
(-2, 0)
(2, -3)
(-1, 2)
(-1, -2)
(-5, 5)

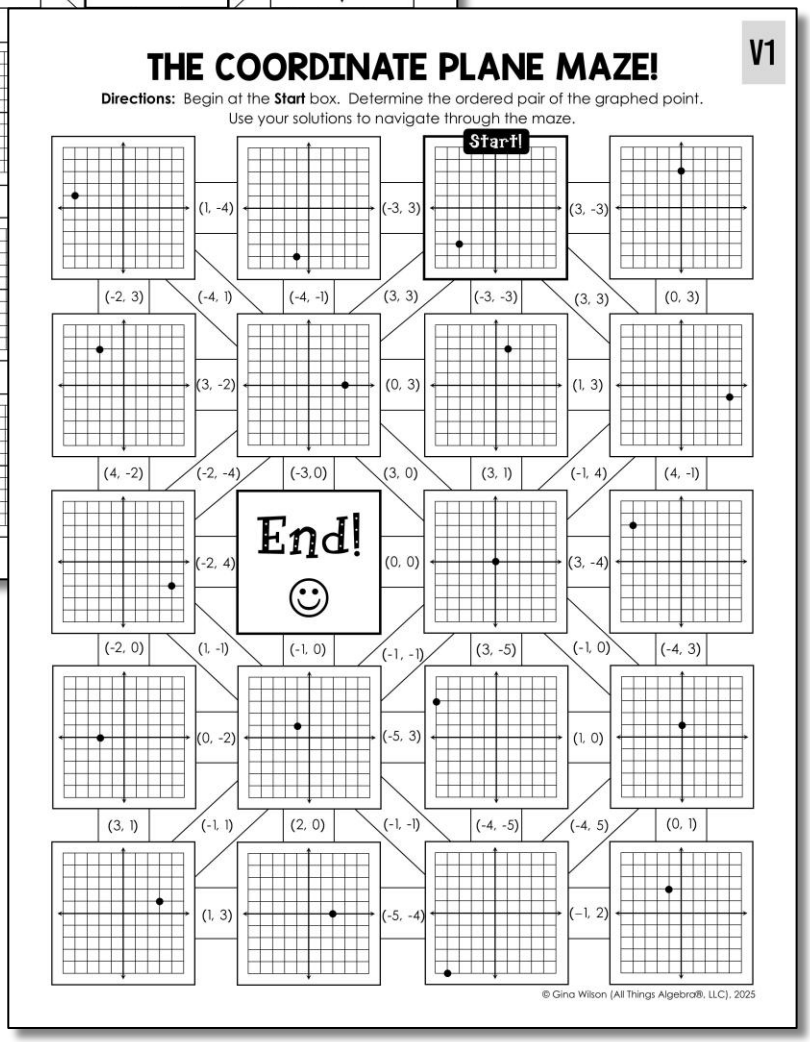
THE COORDINATE PLANE MAZE!
V1
Directions: Begin at the Start box. Determine the ordered pair of the graphed point.
Use your solutions to navigate through the maze.
Start!
(1, -4)
(-3, 3)
(3, -3)
(-2, 3)
(-4, 1)
(-4, -1)
(3, 3)
(-3, -3)
(3, 3)
(0, 3)
(3, -2)
(0, 3)
(1, 3)
(4, -2)
(-2, -4)
(-3, 0)
(3, 0)
(3, 1)
(-1, 4)
(4, -1)
(-2, 4)
End!
(0, 0)
(3, -4)
(-2, 0)
(1, -1)
(-1, 0)
(-1, -1)
(3, -5)
(-1, 0)
(-4, 3)
(0, -2)
(-5, 3)
(1, 0)
(3, 1)
(-1, 1)
(2, 0)
(-1, -1)
(-4, -5)
(-4, 5)
(0, 1)
(1, 3)
(-5, -4)
(-1, 2)
© Gina Wilson (All Things Algebra®, LLC), 2025

3 versions